Naming Angles

Write the missing representation of each angle.

1)

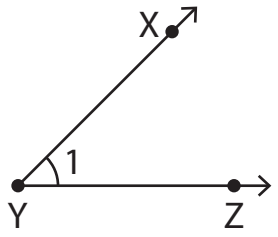

∠ZYX ≅ ∠XYZ ≅ _____ ≅ ∠Y

2)

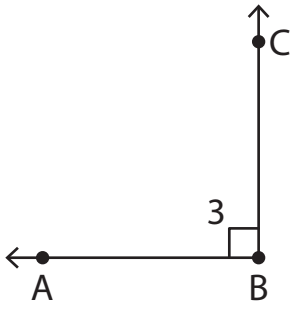

∠ABC ≅ _____ ≅ ∠3 ≅ ∠B

3)

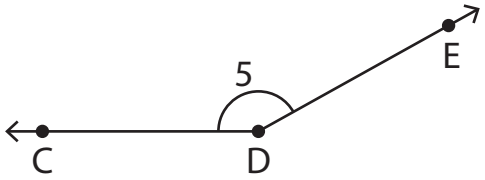

_____ ≅ ∠EDC ≅ ∠5 ≅ ∠D

4)

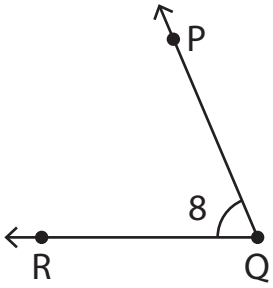

∠PQR ≅ ∠RQP ≅ ∠8 ≅ _____

5)

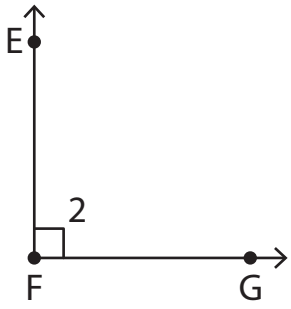

∠EFG ≅ _____ ≅ ∠2 ≅ ∠F

6)

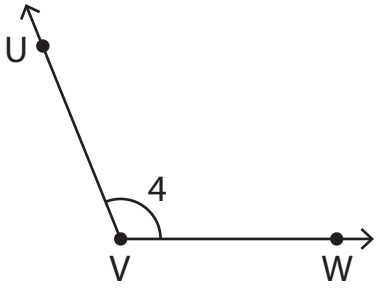

∠UVW ≅ ∠WVU ≅ _____ ≅ ∠V