Squares | Area and Perimeter

Find the area and perimeter of each square.

1)

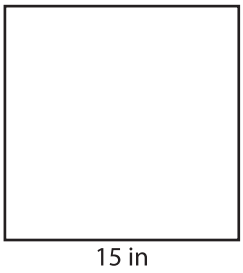

Area = _____

Perimeter = _____

2)



Area = _____

Perimeter = _____

3)



Area = _____

Perimeter = _____

4)

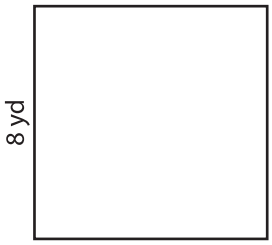

Area = _____

Perimeter = _____

5)



Area = _____

Perimeter = _____

6)

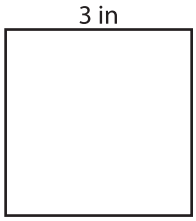

Area = _____

Perimeter = _____

7)



Area = _____

Perimeter = _____

8)

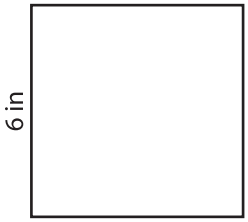

Area = _____

Perimeter = _____

9)

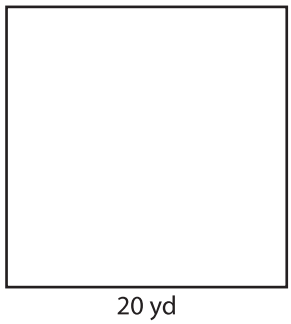

Area = _____

Perimeter = _____