Area of Rectilinear Figures

Find the area of each figure.

1)

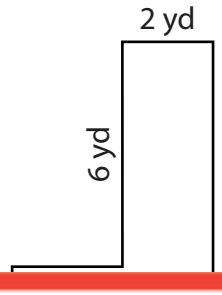

2)

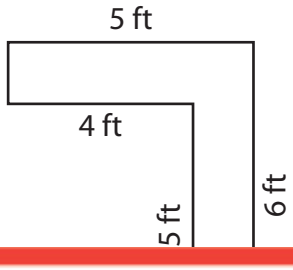

3)

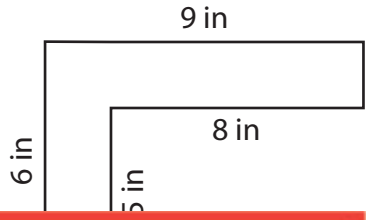

A

4)

6 in

Preview

Become a member to unlock unrestricted access to both printable and online worksheets.

www.tutoringhour.com

Area = _____ Area = _____ Area = _____

7) Alex is painting a wall with an L-shaped mural. The larger section of the mural measures 4 feet by 3 feet, while the smaller section measures 2 feet by 1 foot. What is the total area of the mural on Alex's wall?

_____