Area of Rectilinear Figures

Find the area of each figure.

1)

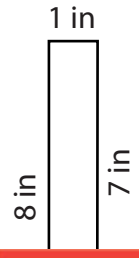

2)

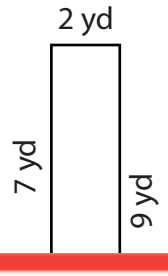

3)

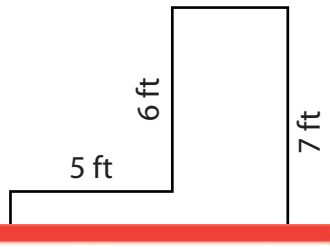

A

4)

Preview

Become a member to unlock unrestricted access to both printable and online worksheets.

www.tutoringhour.com

Area = _____ Area = _____ Area = _____

7) A baker is decorating a cake with an L-shaped pattern. The longer section of the pattern measures 6 inches by 4 inches, while the shorter section measures 3 inches by 2 inches. What is the combined area of the two sections of the cake's decoration?

_____